MAT PL1 3.r.A II.A Meno žiaka: .....

1. **Precvič si písanie číslic.**

11									
13									
18									
16									

2. **Nakresli daný počet predmetov.**

13 

15

3. **Rozlož čísla na desiatky a jednotky.**

13 16 18 20 11

10 3

4. **Vypočítaj.**

10 + 0 =	13 + 2 =	10 + 6 =	15 + 1 =
5 + 3 =	8 + 2 =	10 + 10 =	19 + 1 =
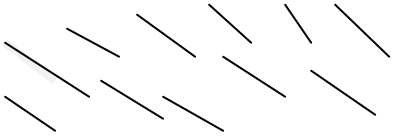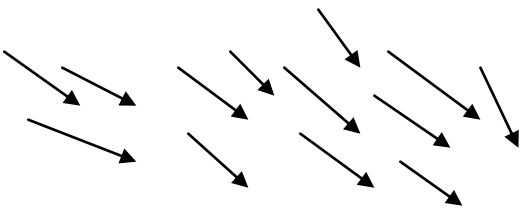
5. **Spočítaj a porovnaj.**